Tens and Ones

To 95

1 Draw ₹ 10 notes and ₹ 1 coins that you will need to pay for the given purchased objects. One has been done for you.

(i) ₹ 53

₹ 10 → 5

₹ 1 → 3

(ii) ₹ 95

₹ 10 → 9

₹ 1 → 5

67

Ones

Tens

(iii) ₹ 67

₹ 10 → 6

₹ 1 → 7

HW

(iv) ₹ 28

HW

(v) ₹ 37



HW

(vi) ₹ 12

2 Write down how many ₹ 10 notes and ₹ 1 coins will you need to buy the following things? One has been done for you.

(i) ₹16

10 + 6

(a) 10 + 1 + 1 + 1 + 1 + 1 + 1

(b) One ₹ 10 note and 6 ₹ 1 coins

(ii) ₹44

40 + 4

(a) 10 + 10 + 10 + 10 + 1 + 1 + 1 + 1

(b) Four Rs 10 notes and four Rs 1 coins

(iii) ₹17 → 10 + 7 → 17

(a) 10 + 1 + 1 + 1 + 1 + 1 + 1 + 1

(b) one Rs 10 note and seven Rs 1 coins

(iv) ₹35 → 30 + 5

(a) 10 + 10 + 10 + 1 + 1 + 1 + 1 + 1

(b) Three Rs 10 notes and five Rs 1 coins

3 Write the total sum of money. One has been done for you.

(i)

30 + 4 = ₹ 34

(ii)

20+6 = ₹26

(iii)

40+6=₹46

(iv)

50+2=₹52

(v)

20+7=₹27

4 Fill in the blanks. One has been done for you.

(i) 32 = 30 + 2

(ii) 97 = 90 + 7

(iii) 65 = 60 + 5

(iv) 29 = 20 + 9

(v) 83 = 80 + 3

(vi) 92 = 90 + 2

(vii) 58 = 50 + 8

(viii) 28 = 20 + 8

(ix) 69 = 60 + 9

(x) 82 = 80 + 2

Practice Time



Now you write these and also say them aloud.

27 = 20 + 7

31 = 30 + 1

54 = 50 + 4

99 = 90 + 9

63 = 60 + 3

36 = 30 + 6

82 = 80 + 2

12 = 10 + 2

19 = 10 + 9

11 = 10 + 1

17 = 10 + 7

19 = 10 + 9

13 = 10 + 3

14 = 10 + 4

Ask students if they also know counting in some other language. Discuss if the number names in that language also suggest the break-up.

Can you do this without Uncle's help? Draw the 10-rupee notes and 1-rupee coins you will give for these things.

Rs 20 — ₹10 ₹10

30+2

Rs 32 — ₹10 ₹10 ₹10 1 1 ₹10 ₹10 ₹10 1 1 ₹10 ₹10 1 1 1

Rs 55

50+5

- How much money do the notes and coins make?

= Rs 30

= Rs 23

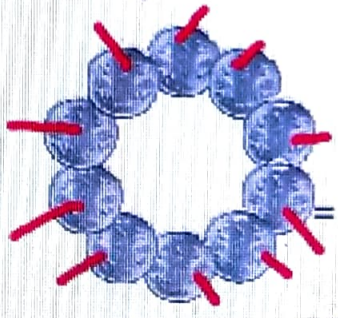

= Rs 10

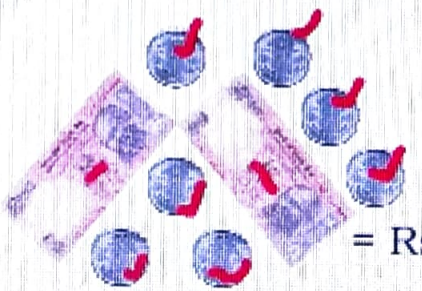

= Rs 27



= Rs 45

Do similar exercises in the class with the help of play money.